Count money – pounds (notes and coins)

1 Match each coin or note to its value.













£1	£5	£2	£20	£50	£10

© White Rose Education 2022

2 How much money is there?

a) 

£ ☐

b) 

£ ☐

c) 

£ ☐

© White Rose Education 2022

2 **d)**



£ ☐

e)



£ ☐

© White Rose Education 2022

3 How much money is there?

a)





£ ☐

b)







£ ☐

c)









£ ☐

© White Rose Education 2022

4 Complete the bar models.

a)



b)



c)



© White Rose Education 2022

5 Write <, > or = to compare the money.

a) 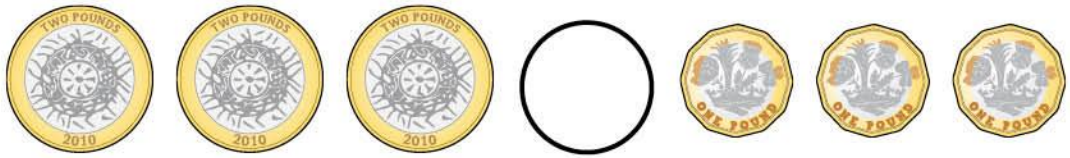

b) 

c) 

© White Rose Education 2022

6 Sam has this money.



Ron has this money.





Is Ron correct? _____

How do you know?

© White Rose Education 2022

7 Mo has this money.





Do you agree with Tiny? _____

Talk about it with a partner.

© White Rose Education 2022