Count money – pounds (notes and coins)

1 What is the value of each coin or note?



2 How much money is there?

a) 

b) 

c) 

d) 

e) 

3 How much money is there?

a) 

b) 

c) 

4 Complete the bar models.

a)



b)



c)



5 Write <, > or = to compare the money.

a) 

b) 

c) 

© White Rose Education 2022

4 Complete the bar models.



a)



b)



c)



5 Write <, > or = to compare the money.



a)



b)



c)



6 Sam has this money.



I have more money because I have notes.



Ron has this money.



Is Ron correct?

How do you know?



7 Mo has this money.



Mo has £25



Do you agree with Tiny?

Talk about it with a partner.



© White Rose Education 2022